Rituels en autonomie : Mardi 19 Mai

A) Pose et calcule les opérations suivantes.

528 + 7 + 94

48 X 7

827 - 43

554 - 65

408 + 76 + 264

65 X 6

B) Lis et écris l'heure : (quand tu peux, utilises les termes demie, quart, moins vingt-cinq, moins vingt, moins le quart, moins dix, moins cinq).

matin



après-midi



matin



C) Dessine les aiguilles des horloges en fonction de l'heure inscrit en dessous. Attention l'aiguille des heures doit être plus petite que celle des minutes.

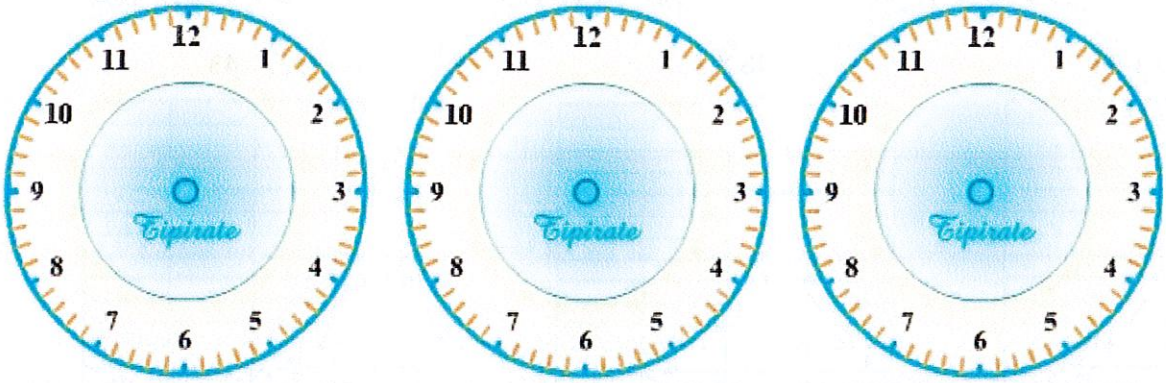

3 h et quart | 3 h et demie | 4 h moins le quart

D) Résous les problèmes.

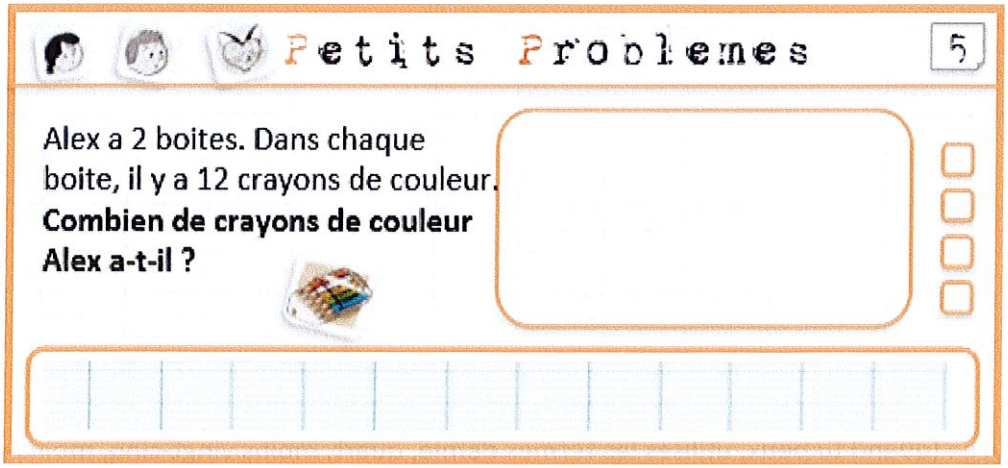

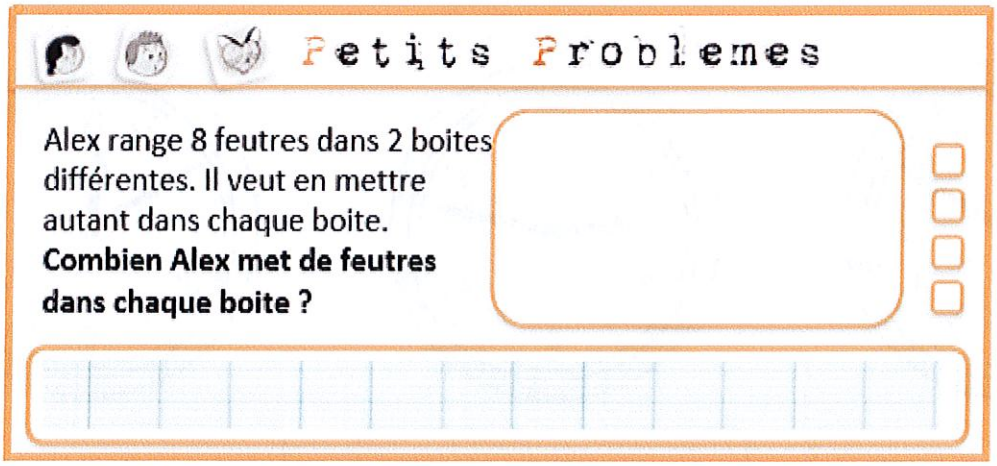

Correction Rituels en autonomie : Mardi 19 Mai

A) Pose et calcule les opérations suivantes.

528 + 7 + 94

```
  1 1
  528
+   7
+  94
  ---
  629
```

48 X 7

```
  5
  48
x  7
  ---
  336
```

827 - 43

```
  827
  1
-  43
  +1
  ---
  784
```

554 - 65

```
  554
  1 1
-  65
  +1 1+
  ---
  489
```

408 + 76 + 264

```
  1 1
  408
+  76
+ 264
  ---
  748
```

65 X 6

```
  3
  65
x  6
  ---
  390
```

B) Lis et écris l'heure : (quand tu peux, utilises les termes demie, quart, moins vingt-cinq, moins vingt, moins le quart, moins dix, moins cinq).

matin



Il est 7 h 10

après-midi



Il est 21 h 13

matin

Il est 11 h moins dix

C) <u>Dessine les aiguilles des horloges en fonction de l'heure inscrit en dessous</u>. Attention l'aiguille des heures doit être plus petite que celle des minutes.

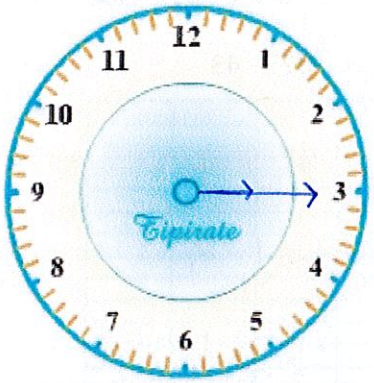

3 h et quart

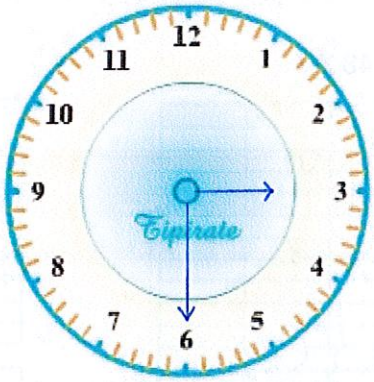

3 h et demie

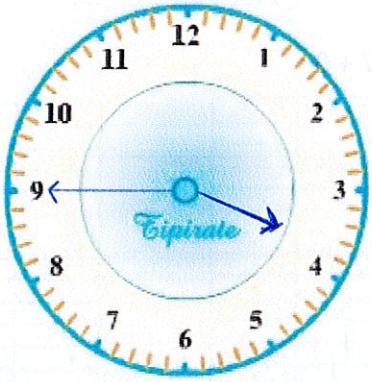

4 h moins le quart
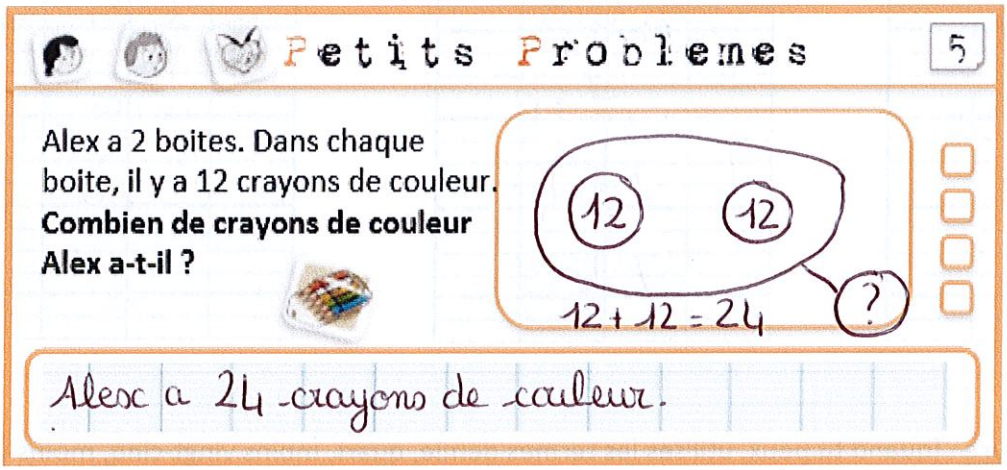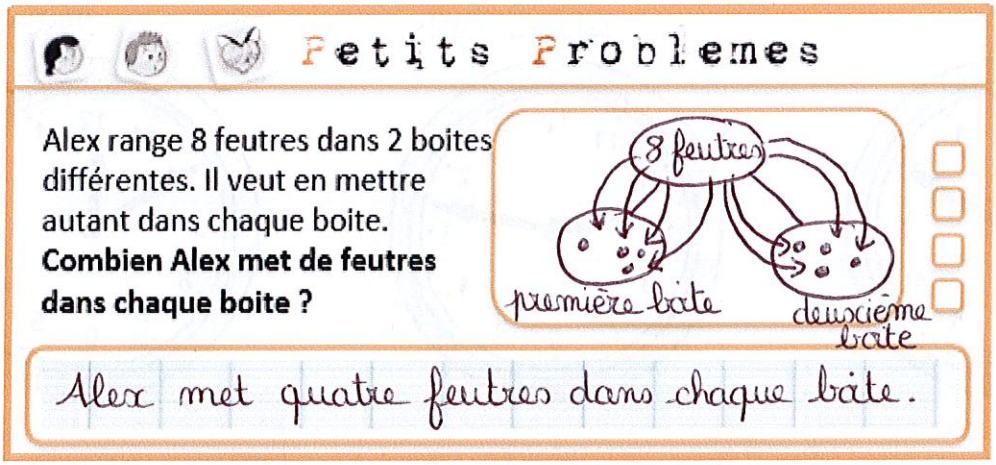
D) <u>Résous les problèmes</u>.