Feuille Exercices 2

Mesures

Fiche 9

Les heures

1 J'écris les heures indiquées sur ces horloges. Nous sommes l'après-midi.

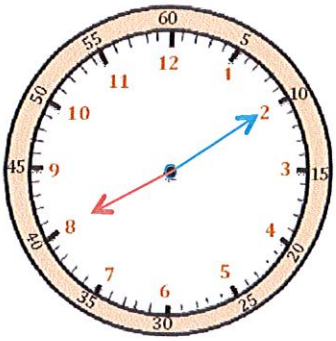

Il est ____ h et ____min.

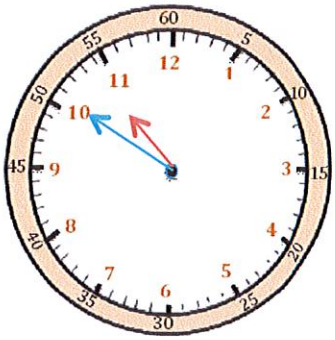

Il est ____ h et ____min.

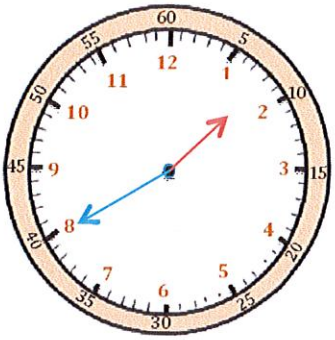

Il est ____ h et ____min.

2 J'écris les heures indiquées sur ces horloges. Nous sommes le matin.

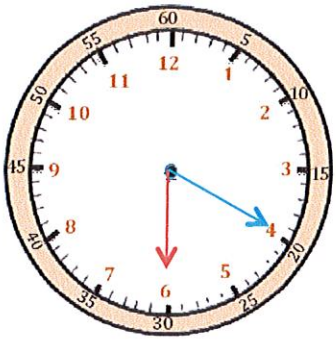

Il est ____ h et ____min.

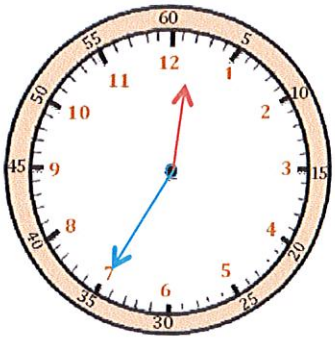

Il est ____ h et ____min.

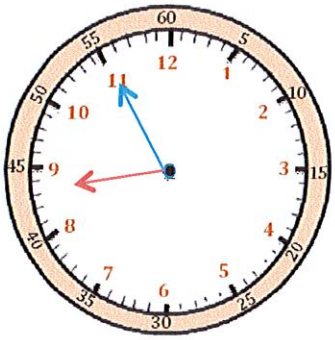

Il est ____ h et ____min.

3 Je place les aiguilles selon les heures indiquées. (heures en **rouge**, minutes en bleu)

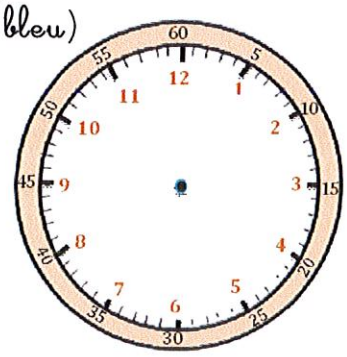

Il est 18 h 45 min.

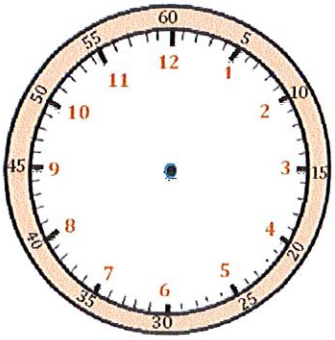

Il est 14 h 25 min.

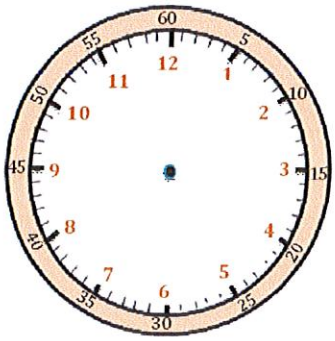

Il est 21 h 50 min.