Feuille Exercices 1

Mesures

Fiche 7

Les heures

1 J'écris les heures du matin et de l'après-midi.

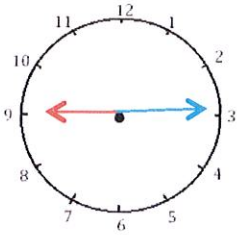

Il est 9 h 15 min.

Il est 21 h 15 min.

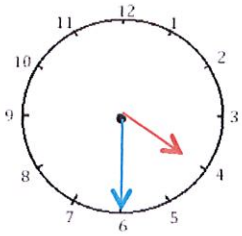

Il est 4 h 30 min.

Il est 16 h 30 min.

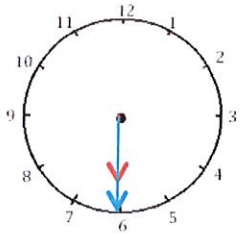

Il est 6 h 30 min.

Il est 18 h 30 min.

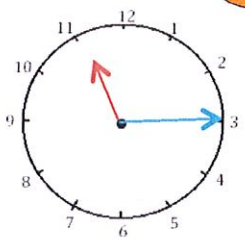

Il est 11 h 15 min.

Il est 23 h 15 min.

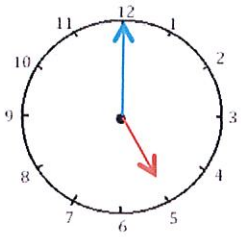

Il est 5 h 00 min.

Il est 17 h 00 min.

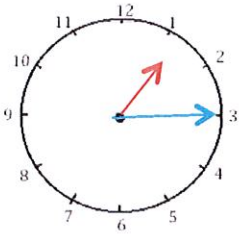

Il est 1 h 15 min.

Il est 13 h 15 min.

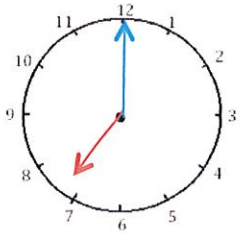

Il est 7 h 00 min.

Il est 19 h 00 min.

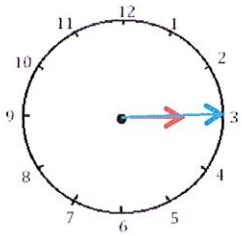

Il est 3 h 15 min.

Il est 15 h 15 min.

2 Je place les aiguilles selon les heures indiquées. (heures en **rouge**, minutes en **bleu**)

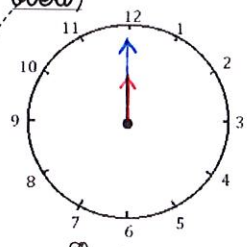

Il est midi.

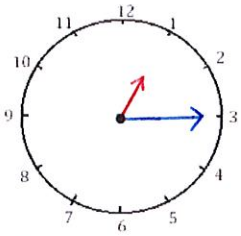

Il est 1 h et quart.

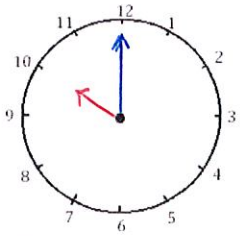

Il est 22 heures.

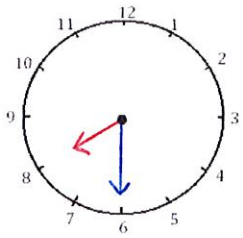

Il est 8 h et demie.

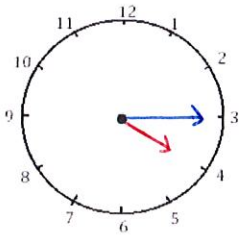

Il est 16 h et quart.

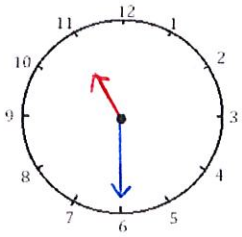

Il est 11 h et demie.

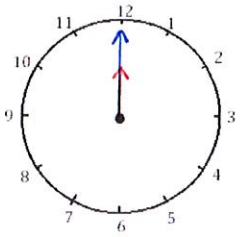

Il est minuit.

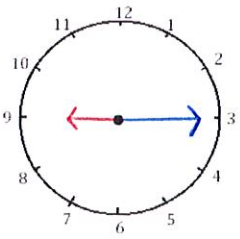

Il est 9 h et quart.