Feuille Exercices 3

Mesures

Fiche 10

Les heures

1 J'écris les heures du matin et de l'après-midi.

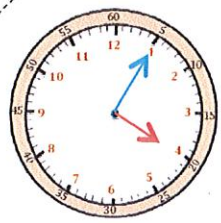

Il est 4 h 05 min.
Il est 16 h 05 min.

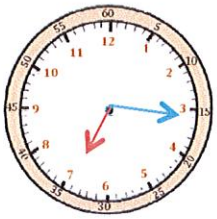

Il est 7 h 16 min.
Il est 19 h 16 min.

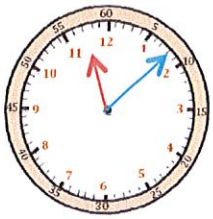

Il est 11 h 08 min.
Il est 23 h 08 min.

Il est 8 h 23 min.
Il est 20 h 23 min.

Il est 2 h 38 min.
Il est 14 h 38 min.

Il est 6 h 11 min.
Il est 18 h 11 min.

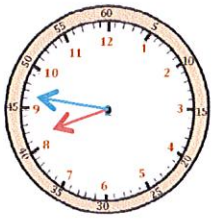

Il est 8 h 46 min.
Il est 20 h 46 min.

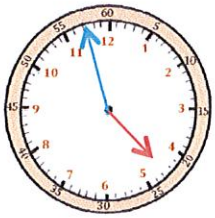

Il est 4 h 57 min.
Il est 16 h 57 min.

2 Je place les aiguilles selon les heures indiquées. (heures en **rouge**, minutes en **bleu**)

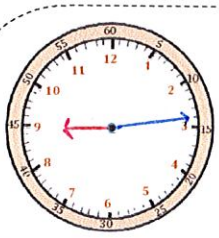

Il est 21 h 14 min.

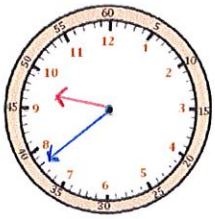

Il est 9 h 38 min.

Il est 14 h 22 min.

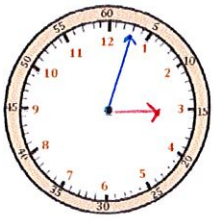

Il est 15 h 03 min.

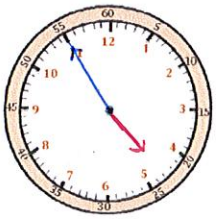

Il est 16 h 55 min.

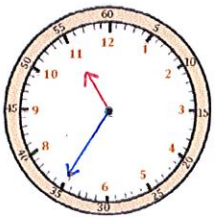

Il est 23 h 35 min.

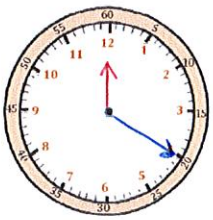

Il est minuit 20 min.

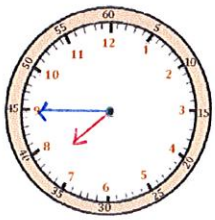

Il est 7 h 45 min.