Feuille Exercices 2

# Mesures

Fiche 9

## Les heures

1 J'écris les heures indiquées sur ces horloges. Nous sommes l'après-midi.

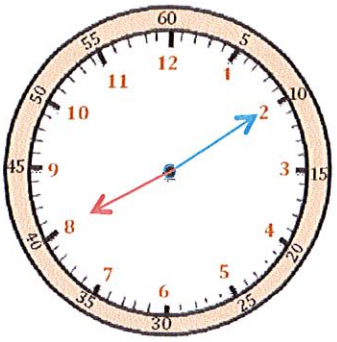

Il est 20 h et 10 min.

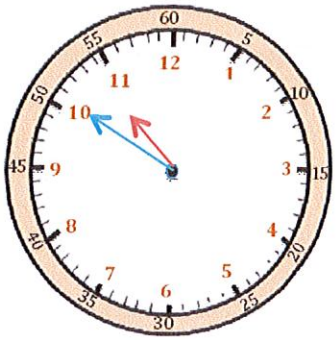

Il est 22 h et 50 min.

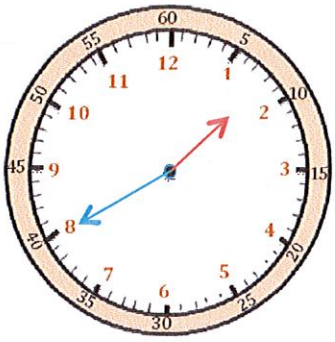

Il est 13 h et 40 min.

2 J'écris les heures indiquées sur ces horloges. Nous sommes le matin.

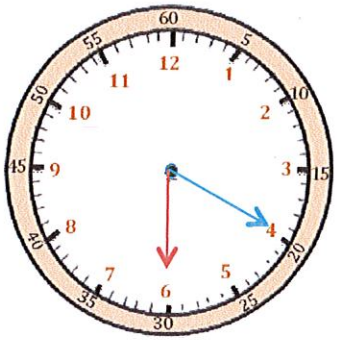

Il est 6 h et 20 min.

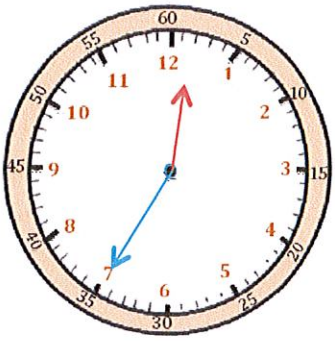

Il est 0 h et 35 min.

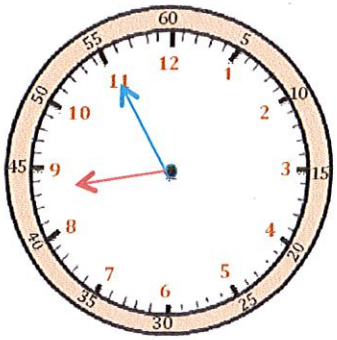

Il est 8 h et 55 min.

3 Je place les aiguilles selon les heures indiquées. (heures en **rouge**, minutes en bleu)

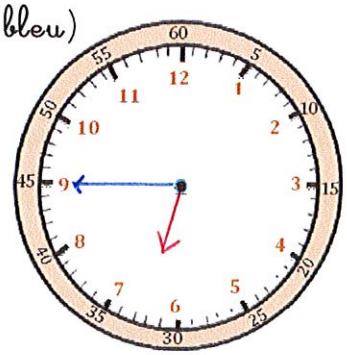

Il est 18 h 45 min.

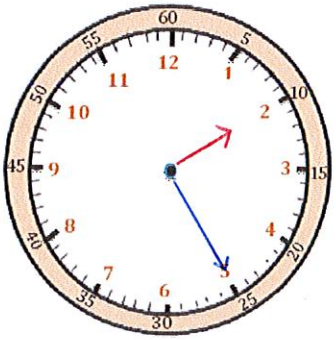

Il est 14 h 25 min.

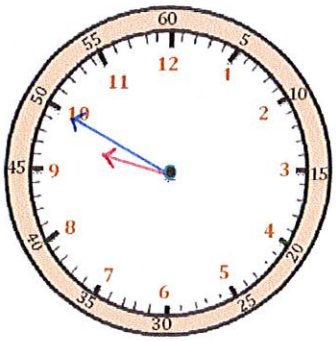

Il est 21 h 50 min.